Finding Volume with Unit Cubes

Name:

Find the length, width and height of the rectangular prism. Then find the volume.

Ex)

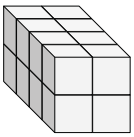

1)

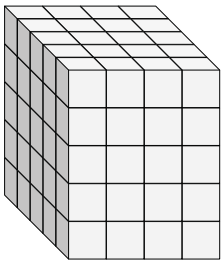

2)

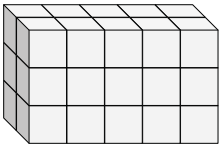

3)

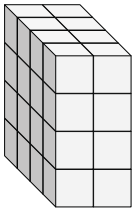

4)

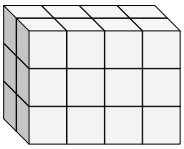

5)

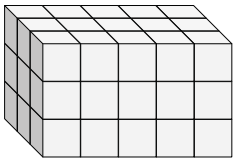

6)

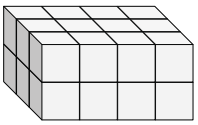

7)

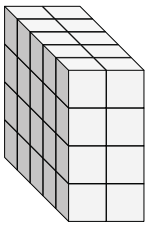

8)

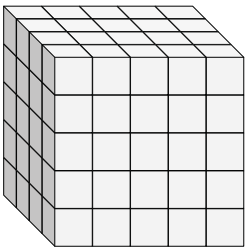

9)

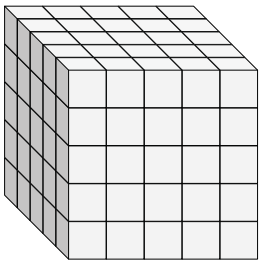

10)

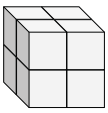

11)

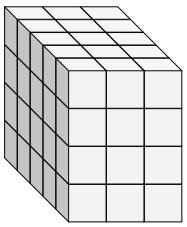

Answers

	L	W	H	V
Ex.	4	2	2	16
1.				
2.				
3.				
4.				
5.				
6.				
7.				
8.				
9.				
10.				
11.				

1-10	91	82	73	64	55	45	36	27	18	9
11	0									

Finding Volume with Unit Cubes

Name: **Answer Key**

Find the length, width and height of the rectangular prism. Then find the volume.

Ex)

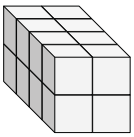

1)

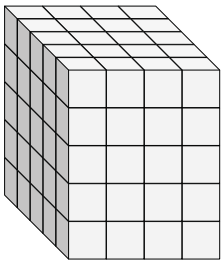

2)

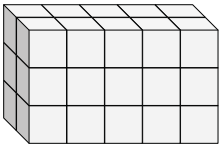

3)

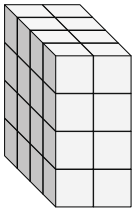

4)

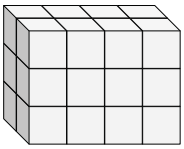

5)

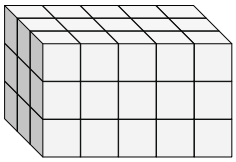

6)

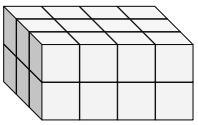

7)

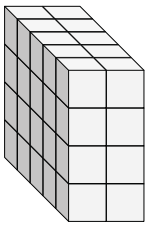

8)

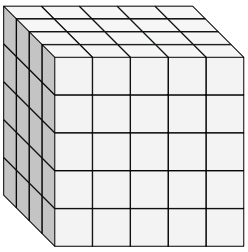

9)

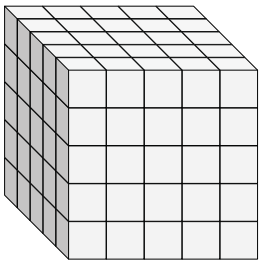

10)

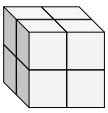

11)

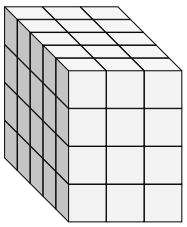

Answers

	L	W	H	V
Ex.	4	2	2	16
1.	5	4	5	100
2.	2	5	3	30
3.	4	2	4	32
4.	2	4	3	24
5.	3	5	3	45
6.	3	4	2	24
7.	5	2	4	40
8.	4	5	5	100
9.	5	5	5	125
10.	2	2	2	8
11.	5	3	4	60

1-10	91	82	73	64	55	45	36	27	18	9
11	0									