Finding Volume with Unit Cubes

Name:

Find the length, width and height of the rectangular prism. Then find the volume.

Ex)

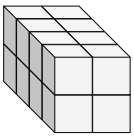

1)

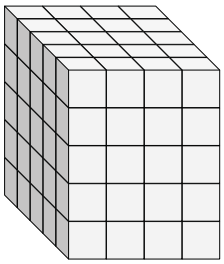

2)

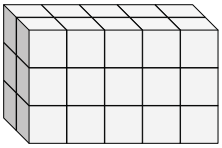

3)

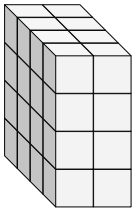

4)

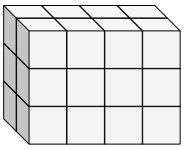

5)

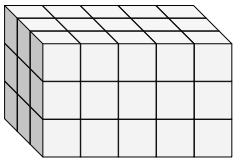

6)

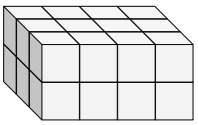

7)

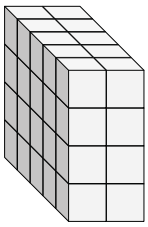

8)

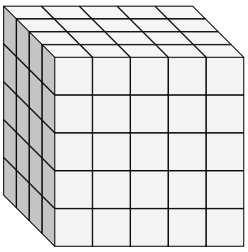

9)

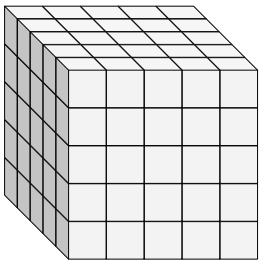

10)

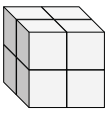

11)

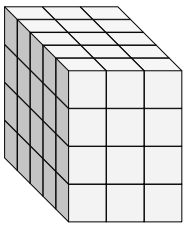

Answers

	L	W	H	V
Ex.	4	2	2	16
1.				
2.				
3.				
4.				
5.				
6.				
7.				
8.				
9.				
10.				
11.				

1-10	91	82	73	64	55	45	36	27	18	9
11	0									